Name: _____

Sr: 10072023-3161

July 10, 2023

MATHS WORKSHEET GENERATOR 11-PLUS SATS GCSES

1) 4 x 12 x 9 ÷ 10

Answer: _____

2) 4 x 12 x 9 ÷ 10

Answer: _____

3) Convert the following fraction into a mixed number: $^{6}/_{2}$

Answer: _____

4) 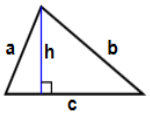

Find area of triangle h = 27 cm, a = 71 cm, b = 96 cm, c = 100 cm

Answer: _____

5) 1^2 ÷ 9 x 8

Answer: _____

6) 89 + (-16)

Answer: _____

7) Decrease 217 by $^{1}/_{31}$

Answer: _____

8) 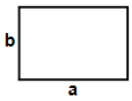

Find area of rectangle having sides a = 77 in and b = 70 in

Answer: _____

9) Round 17.65272 to 4 significant figures.

Answer: _____

10) Simplify 3:19

Answer: _____

11) 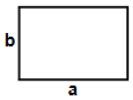

Find area of rectangle having sides a = 73 m and b = 8 m

Answer: _____

12) $25^{2/4}$

Answer: _____

13) 100 - 54

Answer: _____

14) Increase 153 by $^{1}/_{51}$

Answer: _____

15) A number is chosen at random from 1 to 25. Find the probability of selecting multiples of 7.

Answer: _____

Copyright 2023 - Geek School Tutoring Limited

Name: _____

Sr: 10072023-3161

July 10, 2023

16) 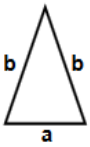

Find area of triangle
a = 39 in, b = 84 in

Answer: _____

17) Find the range of the following set of data:
3, 7, 6, 5, 0.3, 7, 6, 7

Answer: _____

18) Simplify 15:11

Answer: _____

19) Find the median of the following set of data:
28, 38, 37, 10, 15, 21, 38, 6

Answer: _____

20) 159.08 ÷ 9.7

Answer: _____

Total: ___ / 20

Copyright 2023 - Geek School Tutoring Limited

Name: _____

Sr: 10072023-3161

July 10, 2023

MATHS WORKSHEET GENERATOR 11-PLUS SATS GCSES

Answers:

1)	2)	3) 3	4) 1296cm	5)	6) 73	7) 210
8) 5390in	9) 17.65	10) 3 : 19	11) 584m	12) 5	13) 46	14) 156
15) $^{3}/_{25}$	16) 658.61231957807in	17) 6.7	18) 15 : 11	19) 12.5	20) 16.4	

Copyright 2023 - Geek School Tutoring Limited